Squares

Name _____

Side given? Count all the dots. **All the dots given?** Count the side.

EXAMPLE



8 × 8 = 64



___ × ___ = 25



5 × 5 = ___



___ × ___ = 16



12 × 12 = ___



___ × ___ = 9



___ × ___ = 121



4 × 4 = ___



___ × ___ = 100



8 × 8 = ___



9 × 9 = ___



___ × ___ = 81



11 × 11 = ___



2 × 2 = ___



___ × ___ = 144



7 × 7 = ___



10 × 10 = ___



3 × 3 = ___



___ × ___ = 36



___ × ___ = 4

all 3 sheets: 99¢ at colormymath.com

Squares

Side given? Count all the dots. **All the dots given?** Count the side.



8 × 8 = 64



5 × 5 = 25



5 × 5 = 25



4 × 4 = 16



12 × 12 = 144



3 × 3 = 9



11 × 11 = 121



4 × 4 = 16



10 × 10 = 100



8 × 8 = 64



9 × 9 = 81



9 × 9 = 81



11 × 11 = 121



2 × 2 = 4



12 × 12 = 144



7 × 7 = 49



10 × 10 = 100



3 × 3 = 9



6 × 6 = 36



2 × 2 = 4

COLORMYMATH©

Squares Adventure, Part Two: all 3 sheets

This free copy is sheet 1

The whole set is **3 worksheets with every answer**, ready to print:

- Sheet 1: Squares (this one)
- Sheet 2: Squares
- Sheet 3: Times and Share

99¢, instant download

At **colormymath.com/products/squares-part-two-worksheets**. Print as many copies as you need for one home or one classroom.

Or the whole workbook

Every game's sheets, 105 worksheets with the answers in their own file, is the **Every Game Workbook** at colormymath.com.

The game is free

Play it first at **getridoftheteacher.com/squares-part-two**: no ads, no sign-up, nothing locked.

